Time: 10 Minutes **Paper Math 4** **Total Marks: 10**

6th Month, 3rd Week, 5th Day	**Syllabus: Unit 6:** Review Ex – Q No. 9

Q.No.1. Encircle the figure which have the following property: (5)

سوال نمبر1: اُس شکل پر دائرہ لگائیں جس میں درج ذیل خوبی پائی جاتی ہے:

(a) 6 plane surface: **(a) 6ہموار سطحیں:**

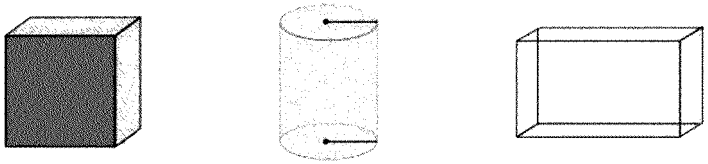

(b) 1 Vertices: **(b) 1 راس**

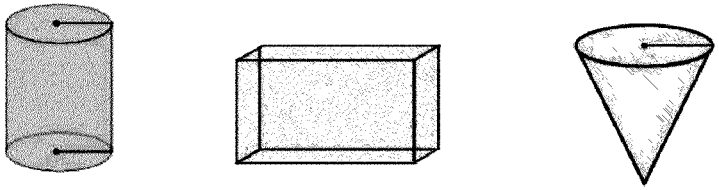

1

Time: 10 Minutes **Paper Math 4** **Total Marks: 10**

6th Month, 3rd Week, 5th Day	**Syllabus: Unit 6:** Review Ex – Q No. 9

Q.No.1. Encircle the figure which have the following property: (5)

سوال نمبر1: اُس شکل پر دائرہ لگائیں جس میں درج ذیل خوبی پائی جاتی ہے:

(a) 6 plane surface: **(a) 6ہموار سطحیں:**

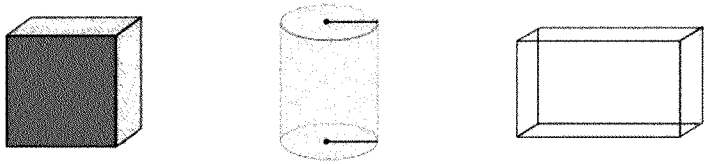
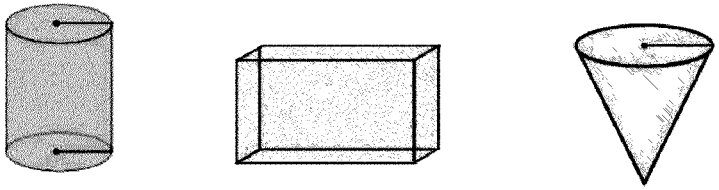
(b) 1 Vertices: **(b) 1 راس**